**SUNSHINE MATH - 1**
**Venus, II**

*Name:*_____

*(This shows my own thinking.)*

★★ 1. Which piece will make this shape if you have more than one of them? Circle the answer.



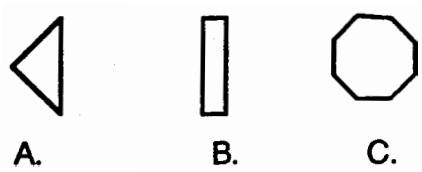


★★ 2. You spent exactly 33¢. Circle the two things that you bought.

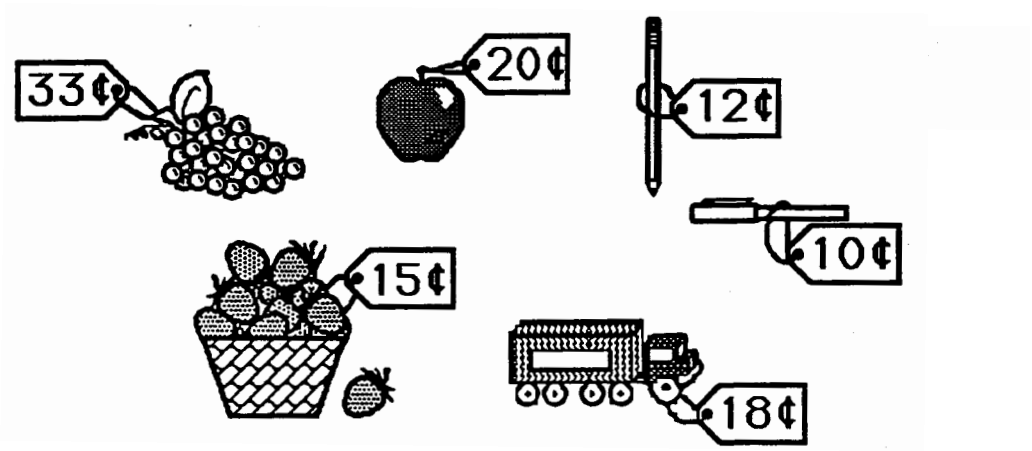


★ 3. Which tile has a different number of dots than the other tiles? Circle the one that is different.

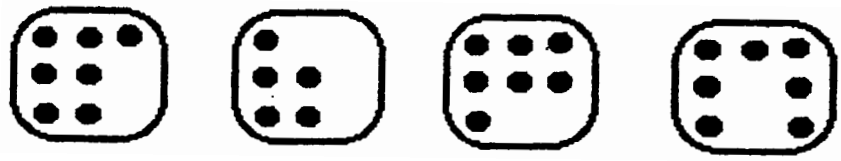

★★★ 4. Five scarecrows had a candy corn eating contest.

Ben ate the most candy corns.
Jen ate more than Len.
Jen ate less than Ken.
Zen ate less than Len.

Write the scarecrows' names in order to show how much candy corn they ate.

Answer: _____ _____ _____ _____ _____
most least

★ 5. Write a number sentence to show how far the rabbit jumped.

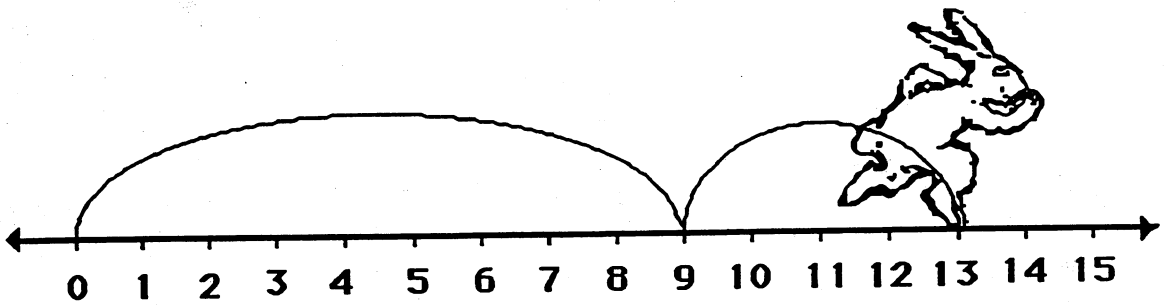


Answer: _____

★★★ 6. Find the mystery number.

Add me to myself.
Then add 2 more.
You will get 14.
Who am I?

Answer: The number is _____.